GCSE Maths: Pythagoras with coordinates, isosceles and equilateral triangles (Foundation): worksheet

GCSE Maths - Pythagoras and Trigonometry - Foundation - Lesson 20.3

Name: _____ Date: _____ Score: _____

11 questions. Write your answers in the spaces. Answers and step-by-step help are free at **websink.site/gcse/maths/ch20-pythagoras-trigonometry/foundation/pythagoras-with-coordinates-isosceles-and-equilateral/**

Exercise 20D Coordinates, isosceles and equilateral triangles

Calculator allowed

1 Work out the distance between each pair of points. Give your answers correct to 1 decimal place when they are not whole numbers.

(a) A(1, 2) and B(4, 6)

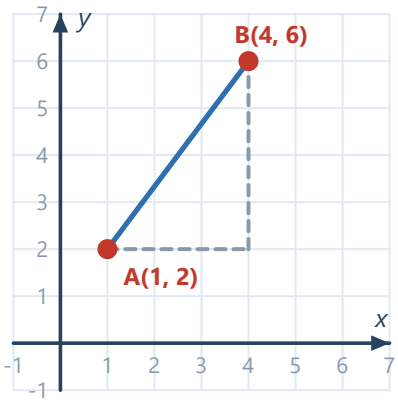

Answer:

(b) C(0, 3) and D(5, −9)

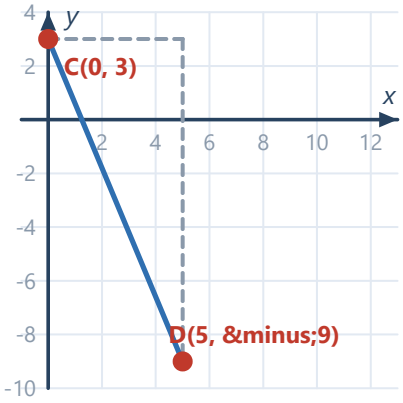

Answer:

(c) P(−4, 2) and Q(3, 5)

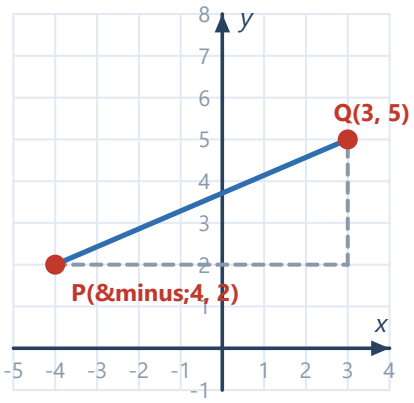

Answer:

(d) R(−6, −1) and S(2, 4)

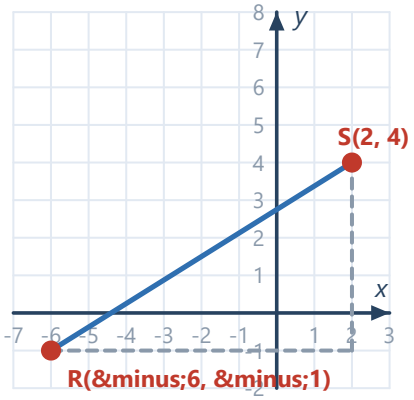

Answer:

2 On a map, each grid square is 1 km wide. A town P is at (2, 3) and a town Q is at (14, 8). Work out the straight-line distance from P to Q.

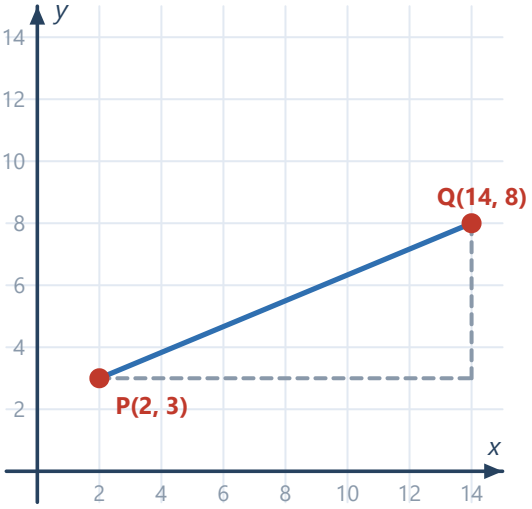

Answer:

3 A(2, 1), B(6, 4) and C(2, 7) are the vertices of a triangle. Show that triangle ABC is isosceles.

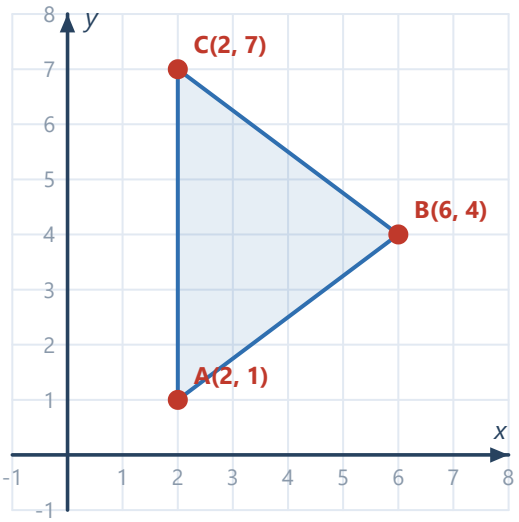

Answer:

4 Each isosceles triangle has the equal sides and the base shown. Work out the perpendicular height *h* of each triangle.

(a) Equal sides 10 cm, base 12 cm

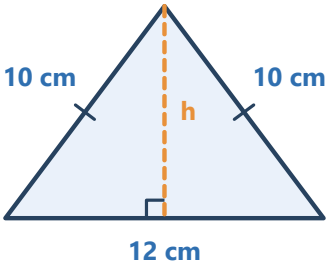

Answer:

(b) Equal sides 13 cm, base 10 cm

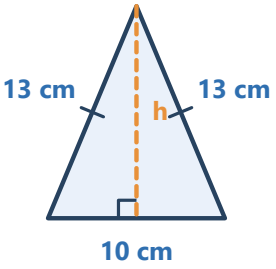

Answer:

(c) Equal sides 17 cm, base 16 cm

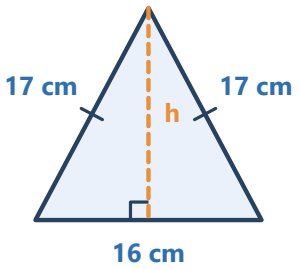

Answer:

(d) Equal sides 6.5 cm, base 5 cm

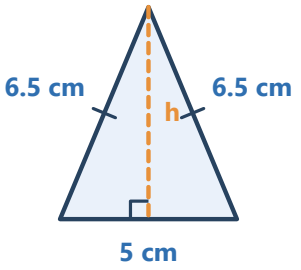

Answer:

5 **An isosceles triangle has two sides of length 10 cm and a base of 12 cm. Work out its area.**

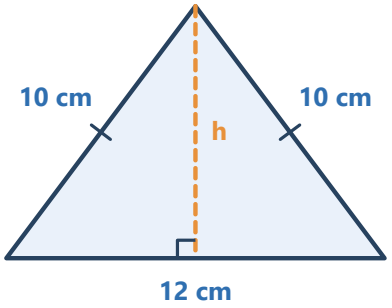

Answer:

6 **An equilateral triangle has sides of length 10 cm. Work out its height. Give your answer correct to 2 decimal places.**

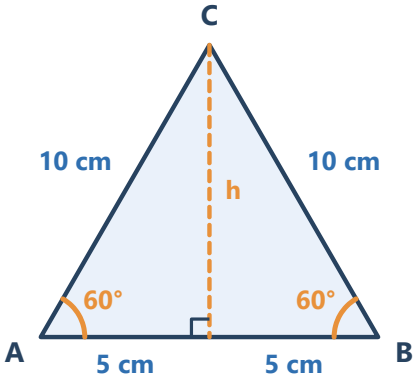

Answer:

7 A roof is supported by an isosceles triangular frame. The two sloping beams are each 5.2 m long and the horizontal span is 9.6 m. Work out the height of the roof frame.

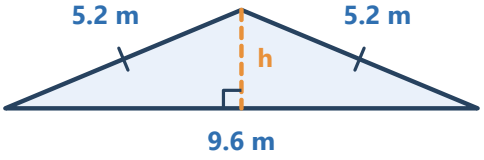

Answer:

8 The cross-section of a tent is an isosceles triangle. The sloping sides are 1.9 m long and the base is 2.4 m wide. Work out the height of the tent. Give your answer correct to 2 decimal places.

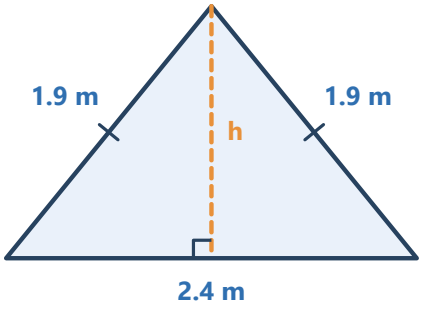

Answer:

9 A road sign is an equilateral triangle of side 50 cm. Work out the area of the sign. Give your answer correct to 1 decimal place.

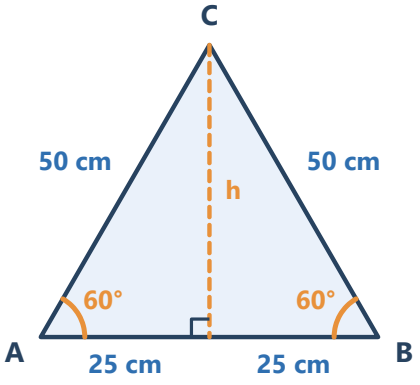

Answer:

10 Zara says: "The distance between A(1, 2) and B(4, 6) is 3 + 4 = 7." Explain why Zara is wrong and work out the correct distance.

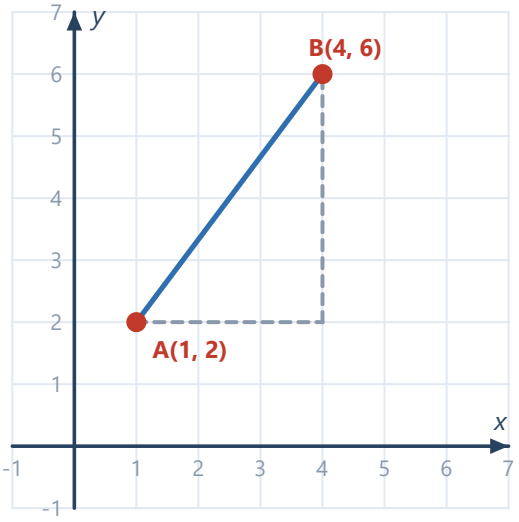

Answer:

11 Isosceles triangle ABC has AB = AC = 17 cm and BC = 16 cm. **Show that** its area is 120 cm^2.

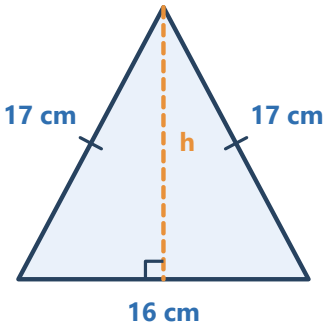

Answer:

© Websink Prep UK. Free for classroom and home use; please do not resell. websink.site