Year 1 Science: Comparing animals, and minibeasts: worksheet

Year 1 - Animal Groups - Lesson 4.6

Name: _____ Date: _____ Score: _____

10 questions. Write your answers in the spaces. Answers and step-by-step help are free at **websink.site/ks1/science/year-1/ch04-animal-groups/comparing-animals-and-minibeasts/**

Exercise 4F Comparing and sorting

1 Which letter is the fish? Look at the picture.



Answer:

2 Which letter is the amphibian?



Answer:

3 Which letter is the reptile?



Answer:

4 Which letter is the bird?



Answer:

5 Which letter is the mammal?



Answer:

6 Which letter is the minibeast?



Answer:

7 How many legs does each animal have? Look at the picture.



(a) Spider (F)

Answer:

(b) Robin (D)

Answer:

(c) Dog (E)

Answer:

8 True or false? A spider is one of the five groups of animals.

Answer:

9 Sort these into two groups: minibeasts, and animals in the five groups. Write the names: ladybird, robin, spider, goldfish.

Answer:

10 Working scientifically: A new animal is found in a garden. How could we find out which group it is in? Name two things you would check.

Answer:

© Websink Prep UK. Free for classroom and home use; please do not resell. websink.site